EJERCICIOS DE GEOMETRÍA 3º F ESO

1. Calcula las siguientes áreas

a)

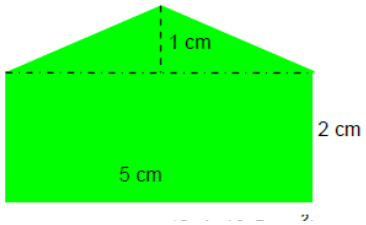

b)

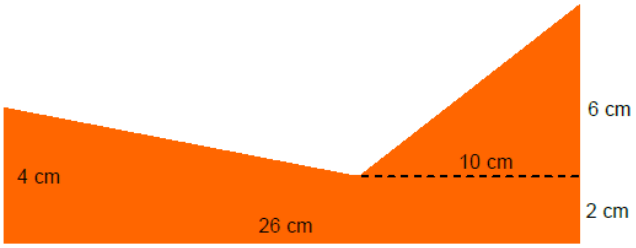

c)

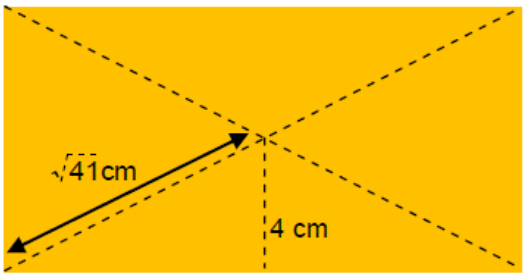

d)

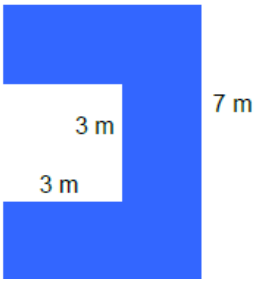

Hallar el área de los siguientes trapecios isósceles:

a)

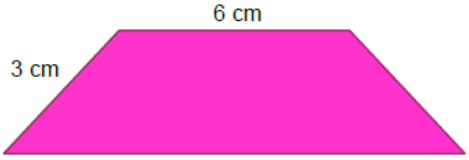

b)

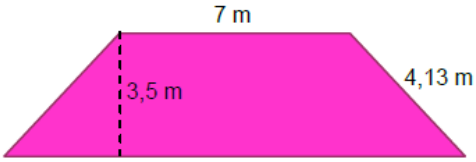

2. Calcula el volumen del prisma recto:

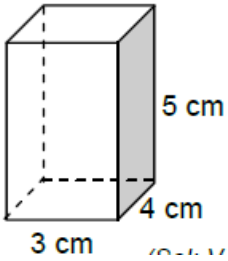

3. Hallar el volumen de las Torres Kio, sabiendo que su base es un cuadrado de 35 m de lado y altura 114 m